NESNE SAYISINI TAHMİN EDELİM

Aşağıdaki nesnelerin sayılarını tahmin edip yazınız. Daha sonra nesneleri sayınız. Bulduğunuz sayıyı gerçek sayı bölümüne yazınız.



Tahminim : .....
Gerçek sayı : .....



Tahminim : .....
Gerçek sayı : .....



Tahminim : .....
Gerçek sayı : .....



Tahminim : .....
Gerçek sayı : .....



Tahminim : .....
Gerçek sayı : .....



Tahminim : .....
Gerçek sayı : .....



Tahminim : .....
Gerçek sayı : .....



Tahminim : .....
Gerçek sayı : .....



Tahminim : .....
Gerçek sayı : .....



Tahminim : .....
Gerçek sayı : .....



Tahminim : .....
Gerçek sayı : .....

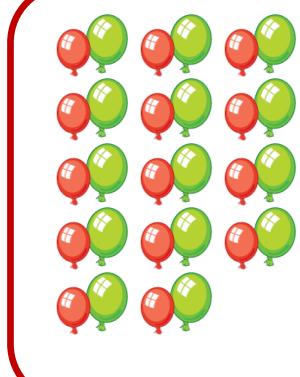

Tahminim : .....
Gerçek sayı : .....



Tahminim : .....
Gerçek sayı : .....



Tahminim : .....
Gerçek sayı : .....



Tahminim : .....
Gerçek sayı : .....



Tahminim : .....
Gerçek sayı : .....



Tahminim : .....
Gerçek sayı : .....



Tahminim : .....
Gerçek sayı : .....



Tahminim : .....
Gerçek sayı : .....



Tahminim : .....
Gerçek sayı : .....